Measurement – Year 4

Reading Scales and Measuring Instruments

Name: _____ Date: _____

Read the scales on each instrument and record the measurement.

1. Rulers

Read the length of each object on the ruler.
Write your answer in the correct unit.

a)

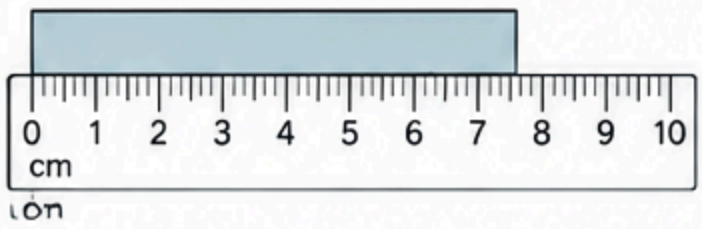

_____ cm

b)

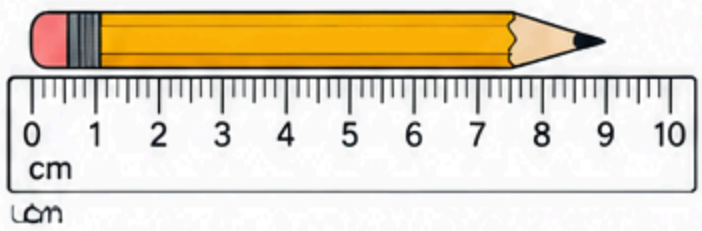

_____ cm

c)



_____ cm

2. Measuring Jugs

Read the volume of each liquid.
Write your answer in millilitres (mL) or litres (L).

a)



_____ mL or L

b)



_____ mL

c)



_____ L

3. Thermometers

Read the temperature on each thermometer.
Write your answer in degrees Celsius (°C).

a)



_____ °C

b)

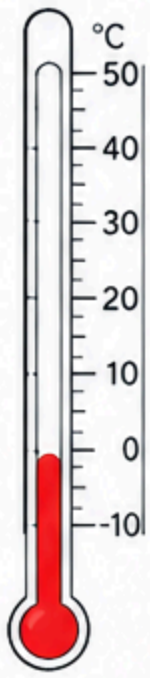

_____ °C

c)



_____ °C

4. Weighing Scales

Read the mass on each scale.
Write your answer in grams (g) or kilograms (kg).

a)



_____ g

b)



_____ g

c)



_____ kg