Name: _____ Date: _____

Shade the Fraction of Shapes

Look at the fraction next to each shape. Shade in the correct part of the shape.

1. Shade the halves.

a)



$\frac{1}{2}$

b)



$\frac{1}{2}$

c)



$\frac{1}{2}$

2. Shade the quarters.

a)



$\frac{1}{4}$

b)

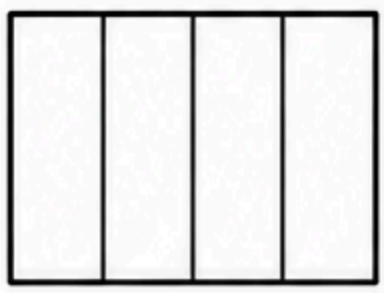

$\frac{1}{4}$

c)

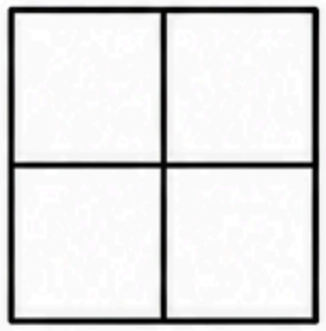

$\frac{1}{4}$

3. Shade the thirds.

a)



$\frac{1}{3}$

b)



$\frac{1}{3}$

c)

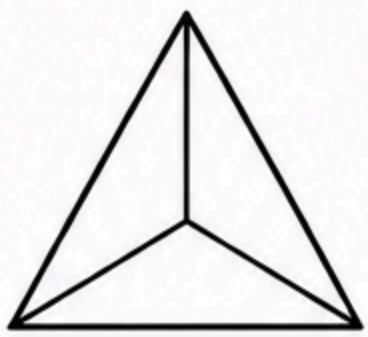

$\frac{1}{3}$