Name: _____ Date: _____

Picture Multiplication Arrays

Count the objects in each array. Write the multiplication equation and the repeated addition sentence.

1. Count the circles.



Multiplication: _____

Repeated addition: _____

2. Count the stars.



Multiplication: _____

Repeated addition: _____

3. Count the squares.



Multiplication: _____

Repeated addition: _____

4. Count the triangles.



Multiplication: _____

Repeated addition: _____

5. Count the hearts.



Multiplication: _____

Repeated addition: _____

6. Count the ovals.



Multiplication: _____

Repeated addition: _____