# Picture Grid Multiplication Arrays

Name: _____ Date: _____

Look at each array of objects. Count the objects, then write the multiplication equations to show the number of rows and the number of columns.

**1.**

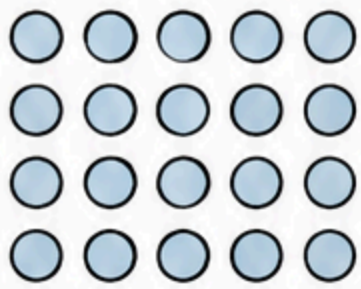

Rows: _____ × _____

Columns: _____ × _____

**2.**



Rows: _____ × _____

Columns: _____ × _____

**3.**



Rows: _____ × _____

Columns: _____ × _____

**4.**



Rows: _____ × _____

Columns: _____ × _____

**5.**



Rows: _____ × _____

Columns: _____ × _____

**6.**



Rows: _____ × _____

Columns: _____ × _____

**7.**



Rows: _____ × _____

Columns: _____ × _____

**8.**



Rows: _____ × _____

Columns: _____ × _____