Name: _____ Date: _____

Measuring Objects with Paper Clips

Count how many paper clips long each object is.



This paper clip is 1 paper clip long.

1.



_____ paper clips long.

2.



_____ paper clips long.

3.

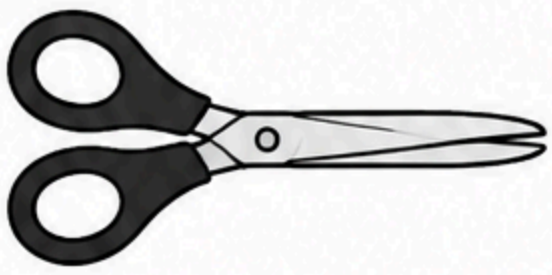

_____ paper clips long.

4.



_____ paper clips long.

5.



_____ paper clips long.

6.



_____ paper clips long.

7.



_____ paper clips long.

8.



_____ paper clips long.



Tip: Look carefully and line up the paper clips along the object.
Count how many fit from end to end.