Name: _____ Date: _____

Picture Division into Equal Groups

Look at the pictures. Divide the set into equal groups and write the corresponding division number sentence.

1. Divide the apples into 4 equal groups.



_____ ÷ 4 = _____

2. Divide the stars into 3 equal groups.



_____ ÷ 3 = _____

3. Divide the frogs into 5 equal groups.



_____ ÷ 5 = _____

4. Divide the ladybirds into 4 equal groups.



_____ ÷ 4 = _____

5. Divide the fish into 3 equal groups.



_____ ÷ 3 = _____

6. Divide the counters into 2 equal groups.



_____ ÷ 2 = _____